TELLING THE TIME · AGES 5–6

# Read the clock

Write the time under each clock, like “half past four”.

Name _____ Date _____ Score _____ / 12

1 

_____

2 

_____

3 

_____

4 

_____

5 

_____

6 

_____

7 

_____

8 

_____

9 

_____

10 

_____

11 

_____

12 

_____

Short hand on a number: it’s that number o’clock. Long hand on 6: it’s half past.

TELLING THE TIME · AGES 5–6

# Draw the hands

Acorn & Ink

Draw the hands to show each time. Make the hour hand short and the minute hand long.

Name _____ Date _____ Score _____ / 12

1 **two o'clock**



2 **half past four**



3 **four o'clock**



4 **eleven o'clock**



5 **half past six**



6 **half past nine**



7 **half past twelve**



8 **half past three**



9 **eight o'clock**



10 **half past seven**



11 **half past five**



12 **five o'clock**



Don't forget: at half past, the hour hand points half way between two numbers.

Acorn & Ink

# Match the clocks

Find the clock that shows each time. Write its letter in the box.

Name _____ Date _____ Score _____ / 9

A



B



C



D



E



F



G



H



I



## The times

| | | |
|---|---|---|
| half past eight ☐ | two o’clock ☐ | half past three ☐ |
| half past seven ☐ | one o’clock ☐ | four o’clock ☐ |
| half past five ☐ | ten o’clock ☐ | twelve o’clock ☐ |

Acorn & Ink

# Blank clock faces

Call out a time to draw, or draw hands and ask “What time is it?” Write the time on the line.

**Name** _____ **Date** _____




_____




_____




_____




_____




_____




_____

# Read the clock

Answers are shown in red.

Name _____ Date _____

1



half past three

2



half past two

3



seven o'clock

4



half past ten

5



half past six

6



four o'clock

7



half past nine

8



half past twelve

9



nine o'clock

10



three o'clock

11



eight o'clock

12



five o'clock

Short hand on a number: it's that number o'clock. Long hand on 6: it's half past.

# Draw the hands

Answers are shown in red.

Name _____ Date _____

1 two o'clock



2 half past four



3 four o'clock



4 eleven o'clock



5 half past six



6 half past nine



7 half past twelve



8 half past three



9 eight o'clock



10 half past seven



11 half past five



12 five o'clock



Don't forget: at half past, the hour hand points half way between two numbers.

# Match the clocks

Answers are shown in red.

Name _____ Date _____

A



B



C



D



E



F



G



H



I



## The times

| | | |
|---|---|---|
| half past eight **C** | two o'clock **G** | half past three **B** |
| half past seven **D** | one o'clock **H** | four o'clock **A** |
| half past five **E** | ten o'clock **F** | twelve o'clock **I** |